Name: Answers Primary 5-a-day Bronze

8th June

Double 51

102

$5 \times 3 \times 2$

30

Muhammad is given £8 pocket money each week.

He is saving for a computer game that costs £64.

How many weeks will it take Muhammad to save enough money?

8

$64 \div 8 = 8$

Which clock shows the time Hannah arrives at school in the morning?

D

Which clock shows the time that Hannah finishes school each day?

A

A



B

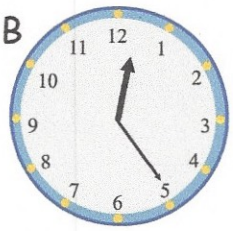

C

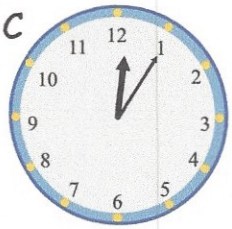

D

© Corbettmaths 2017