Name: _____ Primary 5-a-day Bronze

12th June

$62 + 19 + 24$

$561 - 7$

Arrange these temperatures in order, from lowest to highest

$15°C$ $23°C$ $19°C$ $13°C$

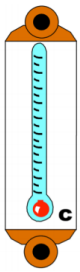

What fraction of this shape is shaded?

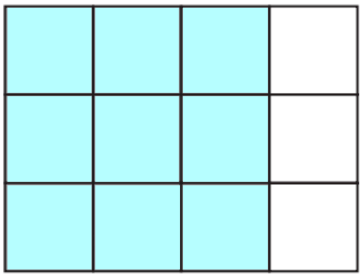

How many **vertices** does a cuboid have?

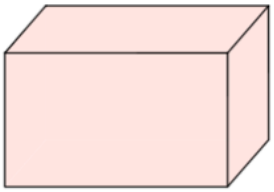

© Corbettmaths 2017